1. Aşağıdaki dijital saatleri öğleden sonraya çevirerek yazalım.

05.30	.	03.00	.
10.00	.	11.25	.
09.15	.	07.45	.
01.40	.	04.30	.

2. Aşağıdaki dijital saatleri öğleden önceye çevirerek yazalım.

20.15	.	15.05	.
17.30	.	18.20	.
19.10	.	03.50	.
21.55	.	14.35	.

3. Aşağıda verilen analog saatlerin öğleden önce ve öğleden sonra gösterdiği saati örnekteki gibi yazalım.



Öğleden Önce

01.00

Öğleden Sonra

13.00



Öğleden Önce

.

Öğleden Sonra

.



Öğleden Önce

.

Öğleden Sonra

.



Öğleden Önce

.

Öğleden Sonra

.

www.eglenerekogrenelim.com

1. Aşağıda verilen saatlerin öğleden sonraki karşılığını yazalım.

a) 08.30 → 20.30

b) 03.05 → .

c) 10.30 → .

d) 07.45 → .

e) 09.25 → .

f) 10.10 → .

g) 05.15 → .

h) 07.35 → .

ı) 04.00 → .

i) 10.45 → .

j) 02.30 → .

k) 08.15 → .

l) 11.00 → .

m) 06.05 → .

n) 01.40 → .

o) 05.30 → .

2. Aşağıda verilen saatlerin öğleden önceki karşılığını yazalım.

a) 16.15 → 04.15

b) 21.30 → .

c) 19.00 → .

d) 15.20 → .

e) 17.55 → .

f) 22.10 → .

g) 19.30 → .

h) 18.15 → .

ı) 14.30 → .

i) 13.45 → .

j) 16.05 → .

k) 23.30 → .

l) 20.15 → .

m) 15.30 → .

n) 21.10 → .

o) 17.25 → .

www.eglenerekogrenelim.com

3. Aşağıda verilen saatlerin öğleden önce ve öğleden sonra gösterdikleri zamanları örnekteki gibi yazalım.

Öğleden Önce: 08.00

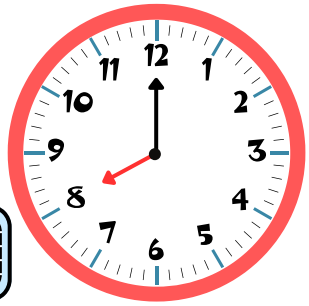

Öğleden Sonra: 20.00

Öğleden Önce: .



Öğleden Sonra: .

Öğleden Önce: .



Öğleden Sonra: .

Öğleden Önce: .

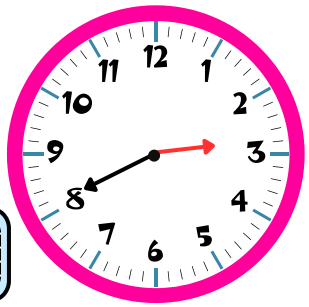

Öğleden Sonra: .

Öğleden Önce: .



Öğleden Sonra: .

Öğleden Önce: .



Öğleden Sonra: .

Öğleden Önce: .

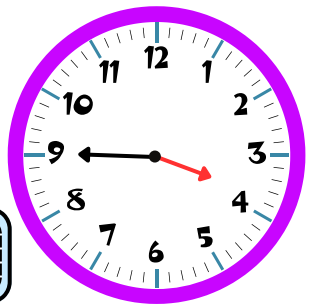

Öğleden Sonra: .

Öğleden Önce: .

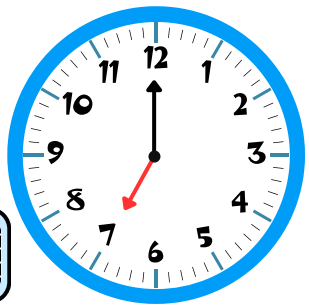

Öğleden Sonra: .

Öğleden Önce: .

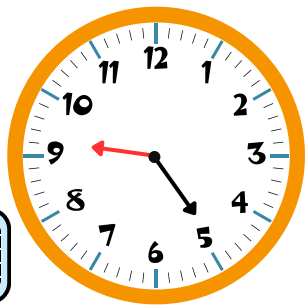

Öğleden Sonra: .

Öğleden Önce: .



Öğleden Sonra: .